1. Tgei diembers sil tschancun dil radi da diembers ein marcai cun paliats?
Noda tes schazetgs tiels paliats.

a

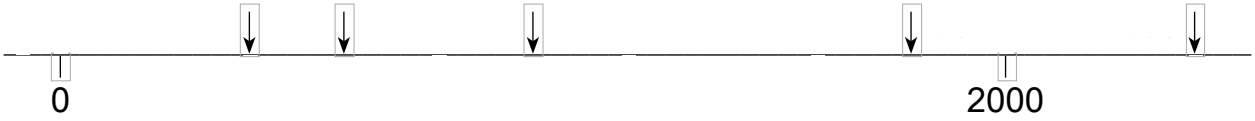

b

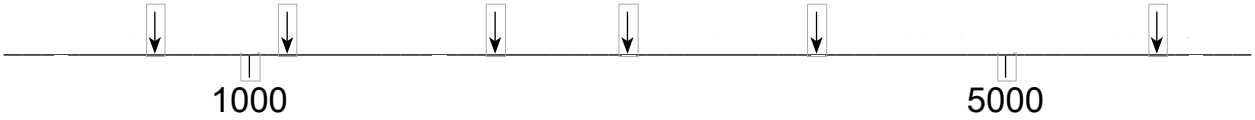

2. Nua sesanflan ils diembers sil tschancun dil radi da diembers? Schazegia.
Noda ils loghens sil radi da diembers. Noda las marcaziuns.

a 4150, 4380, 4400, 4550

b 12 500, 16 000, 18 300, 19 000

3. Tgei datas sil tschancun dil radi da diembers ein marcadas cun in paliet?
Nodas tes schazetgs tiels paliats.

4. Nua schaian las datas sil tschancun dil radi da diembers? Schazegia.
Noda ils loghens sil radi da temps. Noda las marcaziuns.

24. zercladur, 30. zercladur, 3. fenadur, 21. fenadur



© 2014 Lehrmittelverlag Zürich, ab Adobe Reader XI veränderbar